Name:_____ #:____ Date:_____

COMPARING FRACTIONS with the Same Numerator

Directions: Compare the following fractions using < > =.

1. 

2. 

3. 

4. 

5. $\frac{1}{3}$ ☐ $\frac{1}{5}$

6. $\frac{3}{6}$ ☐ $\frac{3}{4}$

7. $\frac{5}{6}$ ☐ $\frac{5}{8}$

8. $\frac{1}{5}$ ☐ $\frac{1}{2}$

9. $\frac{2}{6}$ ☐ $\frac{2}{3}$

10. $\frac{4}{8}$ ☐ $\frac{4}{5}$

11. Evan and Sam were playing basketball. Evan made 2/3 of his shots. Sam made 2/4 of his shots. Who made more shots? **Explain.**

_____

_____

12. Bradley ate 3/6 of his hamburger. Garrett ate 3/4 of his hamburger. Who ate more? **Explain.**

_____

_____

LIVEWORKSHEETS