SUMANDO CON DADOS

ANOTA EL NÚMERO QUE INDICA CADA DADO Y LUEGO RESOLVÉ LA SUMA.

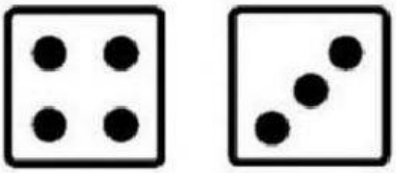

___ + ___ = ___

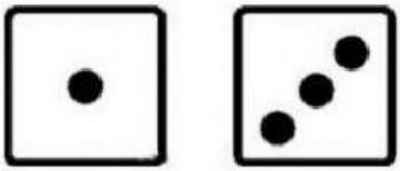

___ + ___ = ___

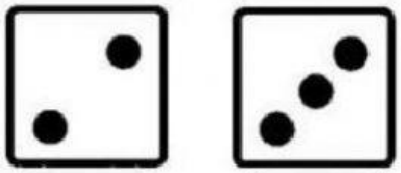

___ + ___ = ___



___ + ___ = ___



___ + ___ = ___



___ + ___ = ___

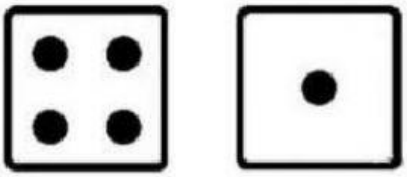

___ + ___ = ___

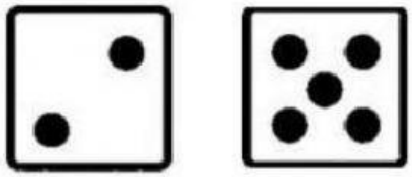

___ + ___ = ___

LIVEWORKSHEETS