1. Na rysunkach przedstawione są graniastosłupy proste o podstawach: prostokąta, trójkąta prostokątnego i rombu. Oblicz ich objętości.

a)

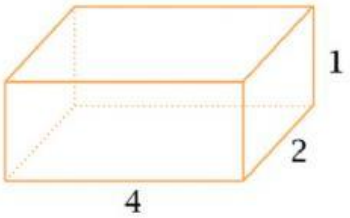

$V =$ .....

b)

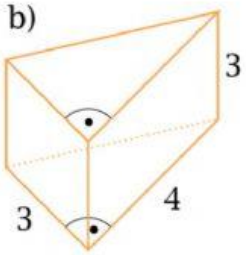

$V =$ .....

c)

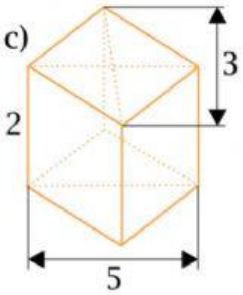

$V =$ .....

LIVEWORKSHEETS