FIGURAS GEOMÉTRICAS

OBSERVÁ LAS PALABRAS DE LOS RECUADROS Y ESCRIBÍ EL NOMBRE DE LOS ELEMENTOS EN EL LUGAR QUE CORRESPONDA.

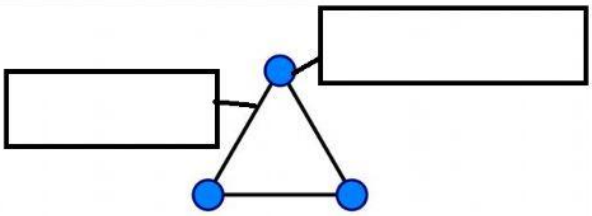

VÉRTICE

LADO

COLOCÁ CUÁNTOS VÉRTICES Y LADOS TIENE CADA FIGURA.



.....LADOS

.....VÉRTICES

.....LADOS

.....VÉRTICES



.....LADOS

.....VÉRTICES

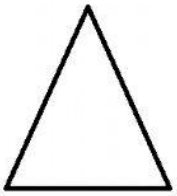

.....LADOS

.....VÉRTICES

UNÍ CON FLECHAS.

TRIÁNGULO



RECTÁNGULO

CÍRCULO

CUADRADO

LIVEWORKSHEETS