Circle all the parallel lines

1) 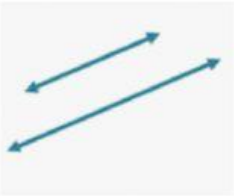

2)

3) 

4)

5)

LIVEWORKSHEETS

Circle all the perpendicular lines

6)

7)

8) 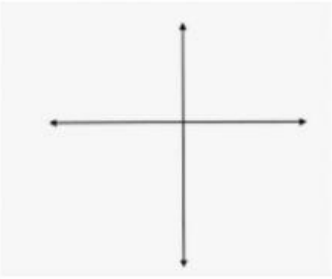

9)

10)

LIVEWORKSHEETS