Mathematics - Mean, Mode, Median & Range

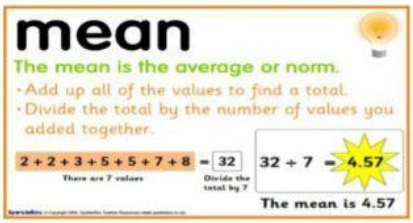

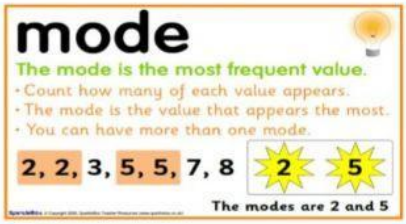

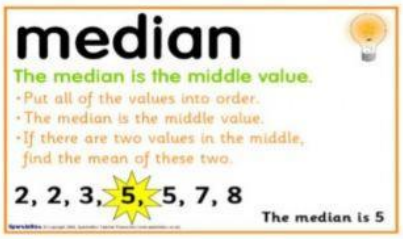

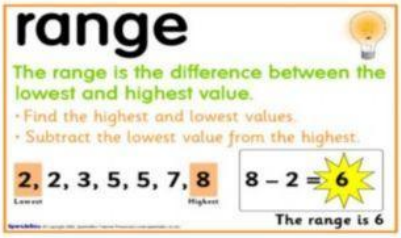

Directions: Find the mean, median, mode, and range for each set of data given.

12, 20, 14, 20, 18, 6

MEAN: _____ MODE: _____

MEDIAN: _____ RANGE: _____

9, 20, 17, 9, 20

MEAN: _____ MODE: _____

MEDIAN: _____ RANGE: _____

19, 20, 7, 11, 14, 19, 7, 15

MEAN: _____ MODE: _____

MEDIAN: _____ RANGE: _____

16, 10, 18, 20, 12, 6, 11, 6, 19, 12

MEAN: _____ MODE: _____

MEDIAN: _____ RANGE: _____

7, 7, 11, 20, 16, 9, 7, 18, 19, 16

MEAN: _____ MODE: _____

MEDIAN: _____ RANGE: _____

9, 17, 12, 11, 17

MEAN: _____ MODE: _____

MEDIAN: _____ RANGE: _____

7, 15, 17, 6, 15, 15, 9

MEAN: _____ MODE: _____

MEDIAN: _____ RANGE: _____

10, 8, 20, 9, 13

MEAN: _____ MODE: _____

MEDIAN: _____ RANGE: _____

Created by Latova Smith-Burrows
LIVEWORKSHEETS