Atividade 5° ano- Figuras Geométricas

E.M Otávio de Farias

Aluno: _____

Professor(a): _____

RELACIONE CADA FIGURA AO SEU NOME

OVAL



RETÂNGULO



CÍRCULO

QUADRADO



TRIÂNGULO

LIVEWORKSHEETS

ARRASTE AS FIGURAS, COLOCANDO-AS NA COLUNA CORRETA DE ACORDO COM A SUA FORMA.



TRIÂNGULO	CÍRCULO	QUADRADO

LIVEWORKSHEETS