	ESCUELA ADVENTISTA DE HUALPÉN Matemática Prof.: Ada Escobar P.	**GUÍA DE EJERCICIOS** *8° Año* ***"Área de figuras geométricas"***
Nombre:		**Fecha:**
Objetivo de Aprendizaje: **OA 13: Desarrollar y aplicar la fórmula del área de triángulos, paralelogramos y trapecios.**		
HABILIDADES: ***Aplicar - Calcular.***		

Área de figuras geométricas

I. Calcula el área (A) de las siguientes figuras geométricas:

1.)

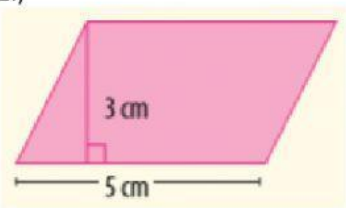

$A =$ ____$cm \times$ ____cm

$A =$ _____cm^2

2.)

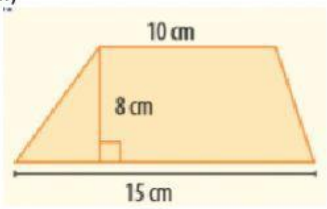

$A = \frac{(____cm + ____cm) \times ____cm}{____}$

$A =$ _____cm^2

3.)

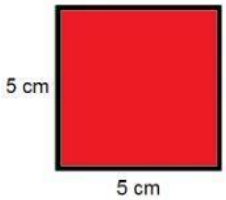

$A =$ ____$cm \times$ ____cm

$A =$ _____cm^2

4.)

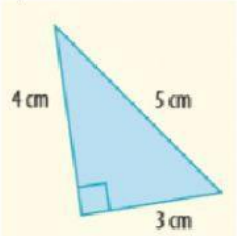

$A = \frac{____cm \times ____cm}{____}$

$A =$ _____cm^2

LIVEWORKSHEETS

5.)

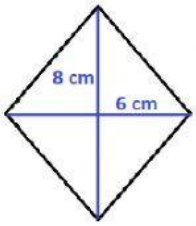

$$A = \frac{____cm \times ____cm}{____}$$

$$A = _____cm^2$$

6.)

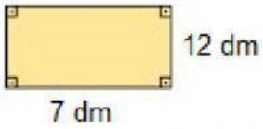

$$A = ____dm \times ____dm$$

$$A = _____dm^2$$

7.)

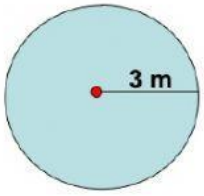

$$A = ____ \times ____m^2$$

$$A = _____m^2$$

8.)

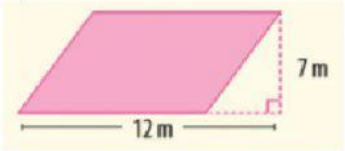

$$A = ____m \times ____m$$

$$A = _____m^2$$

"Amados, si Dios nos ha amado así, debemos también nosotros amarnos unos a otros".
1 Juan 4:11

LIVEWORKSHEETS