Area

Find the mssing length and width given the area of the rectangles

)

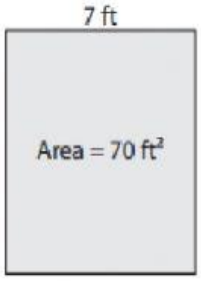

Length = _____

2)

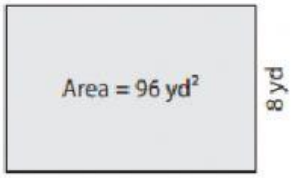

Length = _____

3)

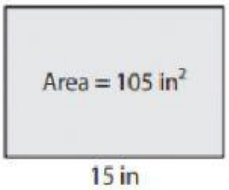

Width = _____

)

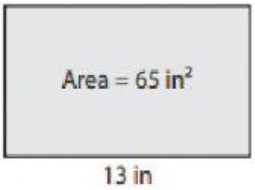

Width = _____

5)

Length = _____

6)

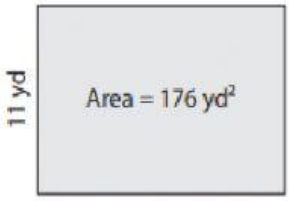

Length = _____

)

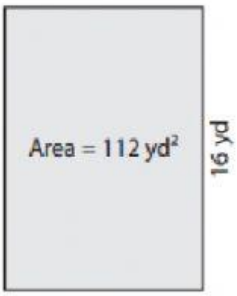

Width = _____

8)

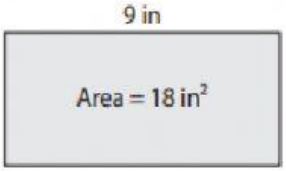

Width = _____

9)

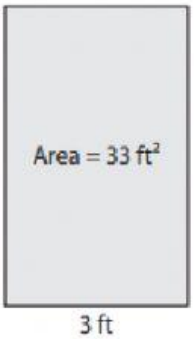

Length = _____

LIVEWORKSHEETS