Special Right Triangles: 45-45-90 Practice

Find the value of x for each triangle

1.

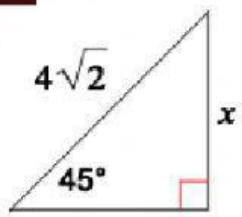

Given: _____

Solve for: _____

2.

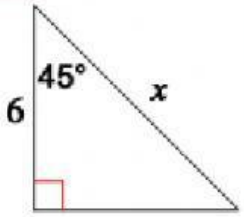

Given: _____

Solve for: _____

3.

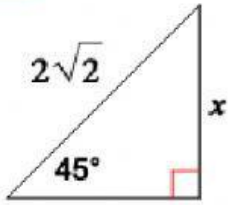

Given: _____

Solve for: _____

4.

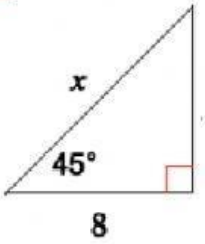

Given: _____

Solve for: _____

5.

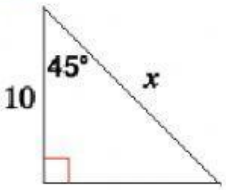

Given: _____

Solve for: _____

6.

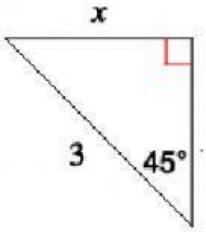

Given: _____

Solve for: _____

LIVEWORKSHEETS