Atividade de Matemática

Nome completo:

01) Qual a área do triangulo que mede, complete corretamente:

a) 6 cm de base e 3cm de altura — 15 cm²
b) 2 m de altura e 1m de base — 9cm²
c) 5 cm de altura e 6 cm de base — 100cm²

02) Observe a figura;

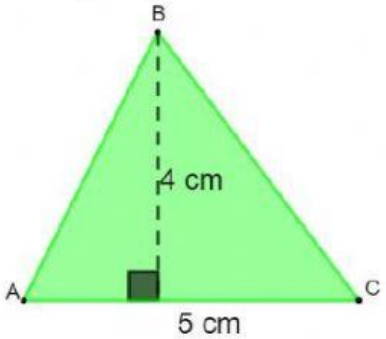

Qual a área desse triângulo?

a) 15 cm²
b) 20 cm²
c) 10 cm²
d) 9 cm²

03) Relacione cada triângulo a sua respectiva área.

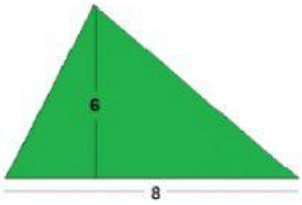

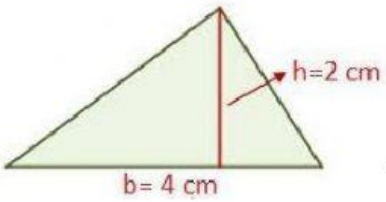

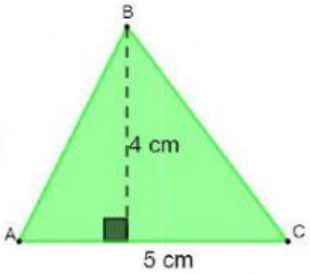

4 cm² 24 cm² 10 cm²

LIVEWORKSHEETS