Complete the tasks from the Learner's book on page 37

2 Suntia has lots of parcels to send.



(a) Put the parcels in order from lightest to heaviest.

(b) How much would each parcel cost to post?



3 Class 5 have been measuring out flour for a cookery lesson.
Each learner started with a 2kg bag of flour.
How much flour is left in each child's bag?
Write your answer in grams.