1. **Write the names of the areas bordering the Great Plain in the boxes on the map below.**

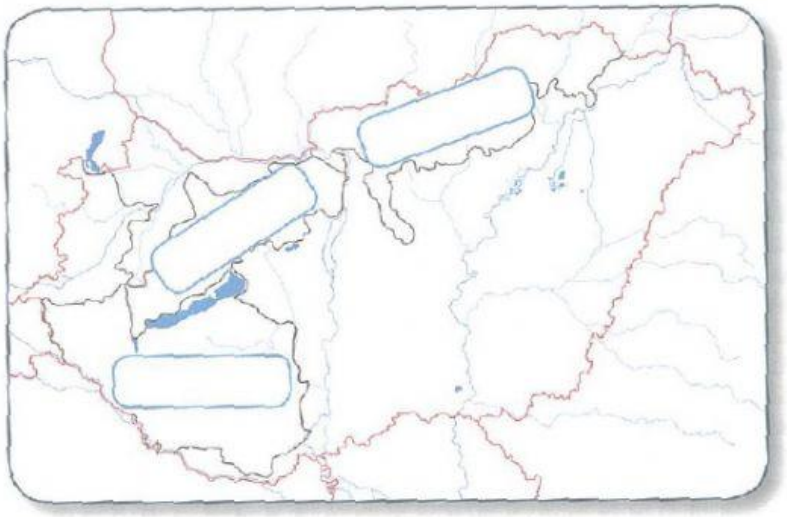

2. **Write the numbers corresponding to the the four main parts of the Great Plain in the circles.**

1. Mezőföld 2. Dráva-mellék 3. Duna–Tisza köze 4. Tiszántúl

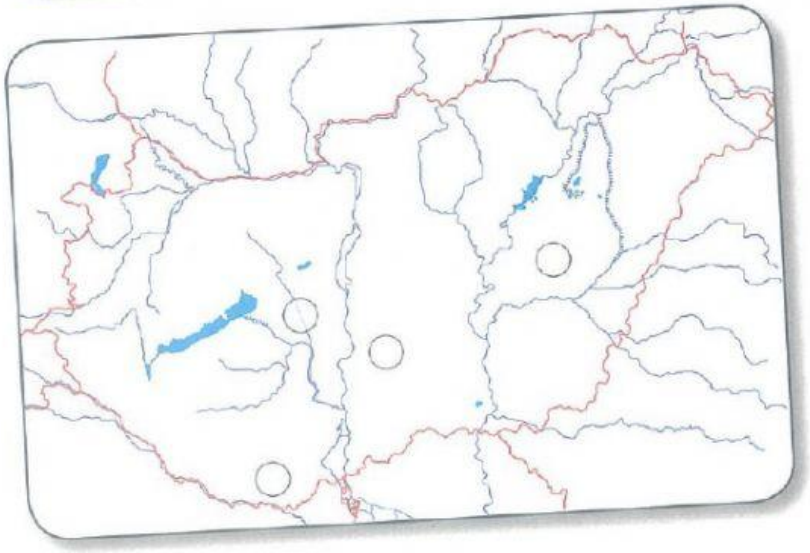

LIVEWORKSHEETS

3. **Write the letters corresponding to the regions in the circles on the map below.**

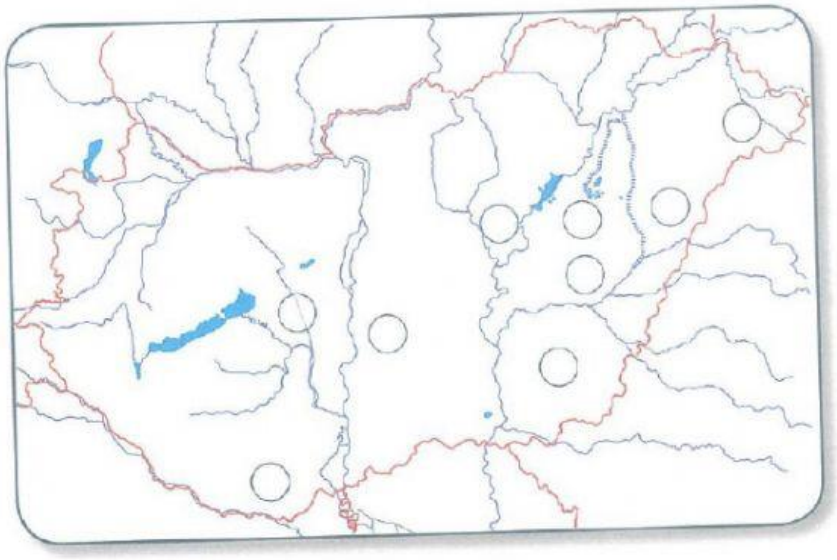

A Hortobágy
B Kiskunság
C Maros-Körös köze
D Nagykunság
E Hajdúság
F Jászság
G Nyírség
E Mezőföld
F Dráva-mellék

4. **Write the letters corresponding to the regions from Exercise 3 under the names of the type of surface that cover these areas.**

Fertile mud: _____

Sand: _____

Loess: _____

5. **Write the letters corresponding to the sentences beside their correct region.**

A The winds built 50–60 m high loess walls.
B The winds blew the sand from the sediment of the rivers, and built 10–15 m high dunes.
C There is a wide band next to the rivers, which is made of fertile mud from the rivers.
D The dunes wander with the changing direction of the winds.
E Further from the rivers, thick grass was able to get a hold of the fine dust carried by the winds.
F During the constant floods, thick layers of sediments were laid down and formed a surface as flat as a table.
G The fine dust laid down by the wind mixed with the sediments of the rivers and developed into a very fertile soil.
H The direction of dunes and lakes mark the direction of the winds that blow from the NW.

Kiskunság, Nyírség: _____

Nagykunság, Hortobágy, Jászság and Dráva-mellék: _____

Maros-Körös köze, Mezőföld, Hajdúság: _____

LIVEWORKSHEETS