Clasificación de Cuadriláteros

1. Arrastra cada uno de los elementos del cuadrilátero en su lugar.

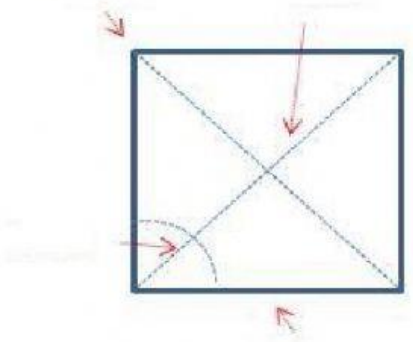

Ángulo | Diagonal | Vértice | Lado

2. Une los puntos de cada cuadrilátero con los puntos de sus características y después con los puntos de sus nombres.



Todos sus lados tienen la misma medida y los ángulos consecutivos diferentes.

Trapecio

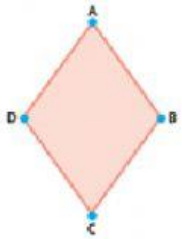

Sus cuatro lados son de diferente medida

Trapezoides

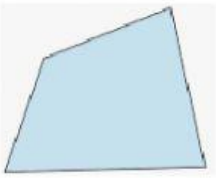

Dos de sus ángulos son rectos

Paralelogramo

LIVEWORKSHEETS

Clasifica los cuadriláteros

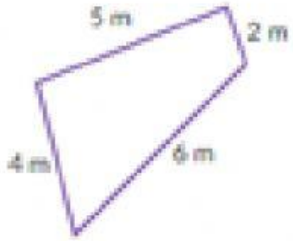



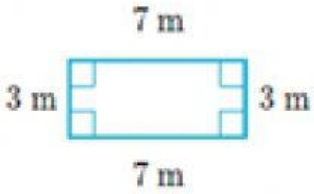

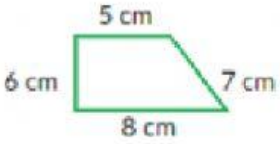

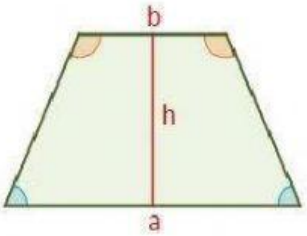

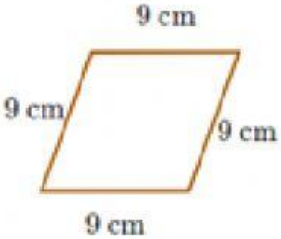

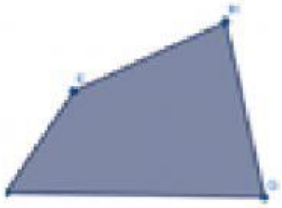

LIVEWORKSHEETS