Name: .....
School: .....
Class: Grade 6
Subject: Science

برنامج التعلم الذاتي
Self-Learning Program

Intractive Worksheet: Week 26/ Self-Learning Program

Exercise 1:

The children are playing rope game.



Cross the incorrect word:

1- The force shown is (PULLING – PUSHING)

2- The two groups are working (TOGETHER – OPPOSITE TO EACH OTHER)

3- The forces are (EQUAL – NOT EQUAL)

4- The forces (DO – DO NOT) balance each other.

5- There will be (MOTION – NO MOTION)

LIVEWORKSHEETS

Exercise 2:

Show whether work is done or not. Fill in with: work done – work not done

		Work is done or not			
	lifting a box		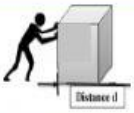	Moving a box for a distance d	
	Box on ground			Pushing wall	
	holding a box			Pulling a trolley	

Exercise 3

Fill the below table based on the figure by drag and drop

5 m	**500 N**	**10m**	**200 N**	**100 N**	**10 m**	**100 N**

	Force	Distance
Ziad		
Rasha		
Hussein		

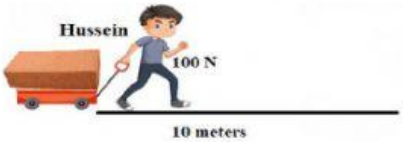

Which one did the greatest work?

Ziad *Rasha* Hussein

LIVEWORKSHEETS