Clasificación de los ángulos

1. Arrastra y ubica los elementos del ángulo según corresponden.

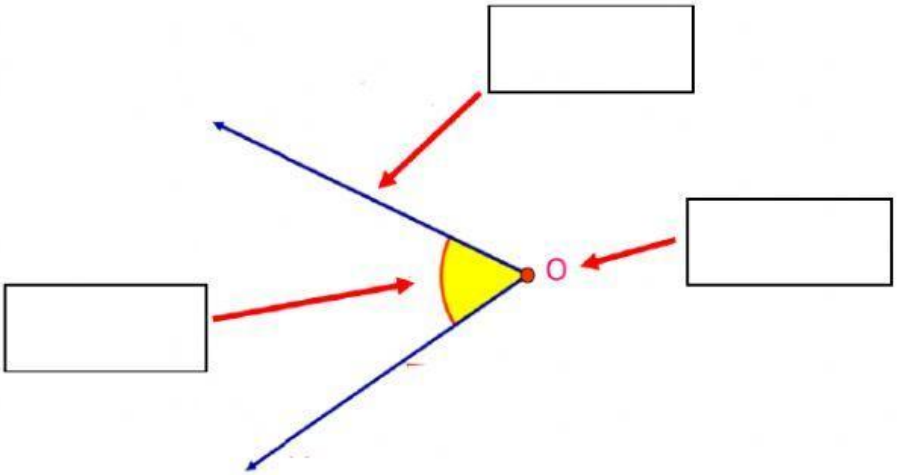

LADO

VÉRTICE

ÁNGULO



2. Arrastra las palabras que corresponden para completar las ideas.

agudos | llanos | obtusos | rectos | completos

a) Los ángulos _____ miden 90°.

b) Los ángulos _____ miden menos de 90°.

c) Los ángulos _____ miden más de 90°.

d) Los ángulos _____ miden 180°.

e) Los ángulos _____ miden 360°.

3. Identifica la clase de ángulo en cada caso

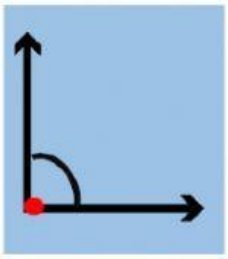

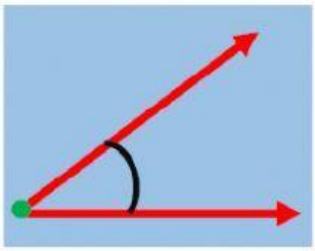

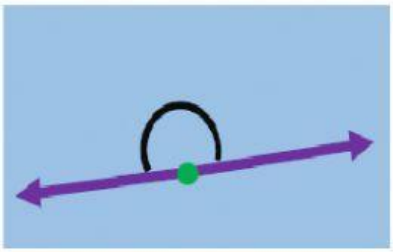

LIVEWORKSHEETS

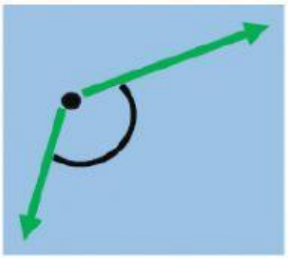

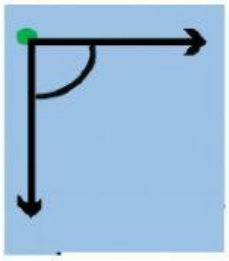

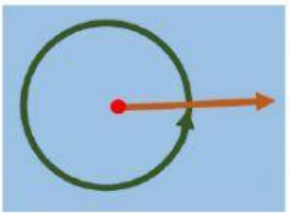

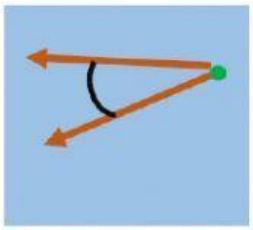

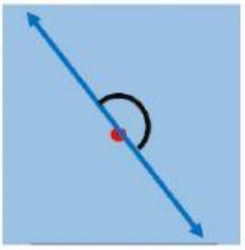

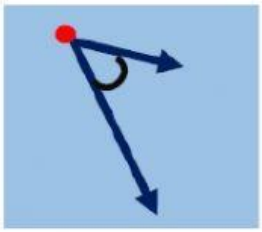

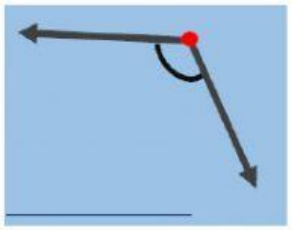

¡Buen trabajo!

LIVEWORKSHEETS