Segmentos Proporcionales

Encuentre el valor x del segmento dado en cada caso para que la proporción $\frac{\overline{AB}}{\overline{DE}} = \frac{\overline{BC}}{\overline{EF}}$, sea correcta.
Remplaza los valores de cada razón, para los valores decimales usa la (,).

1

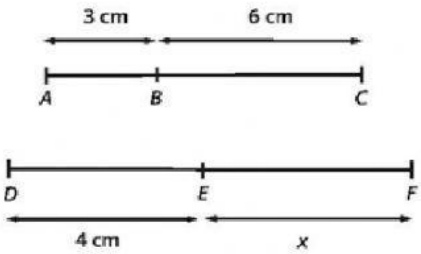

____ = ____

X =

2

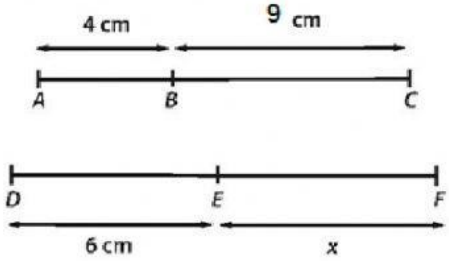

____ = ____

X =

3

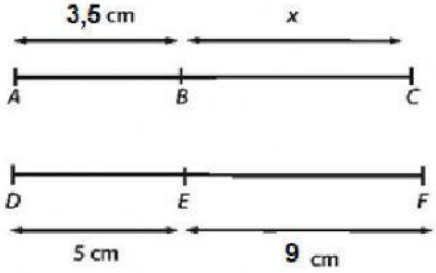

____ = ____

X =

4

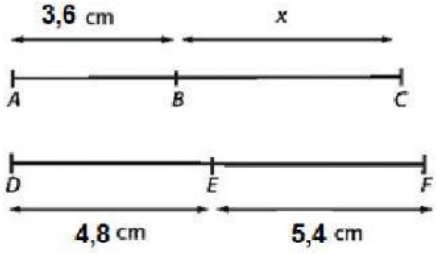

____ = ____

X =

LIVEWORKSHEETS