UNITATEA eta unitatea baino txikiagoak



OSOA

HAMARRENA



EHUNENA

1- Itsatsi hemen gainean goiko taula
2- Azpiko irudietan nahi duzun kopurua koloreztatu eta adierazi azpian zein zatiki eta zenbaki hamartarrez adierazten den zuk margotutako hori.

	$\frac{\quad}{10} =$	 $\frac{\quad}{100} =$

LIVEWORKSHEETS