MOUSA BIN NUSAIR SCHOOL Elite 6

NAME _____ DATE _____ PERIOD _____

Lesson 5

Polygons on the Coordinate Plane

Use the coordinates to find the length of each side of the rectangle. Then find the perimeter.

1. $E(1,7)$, $F(3,7)$, $G(3,4)$, $H(1,4)$

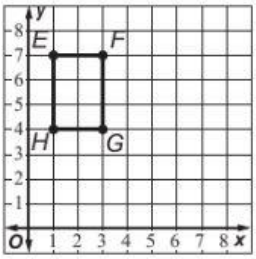

units

2. $W(2,7)$, $X(2,0)$, $Y(6,0)$, $Z(6,7)$

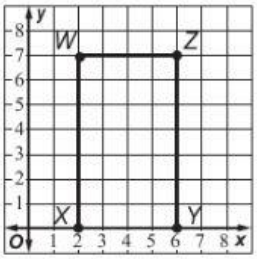

units

Find the area of each figure in square units.

3.

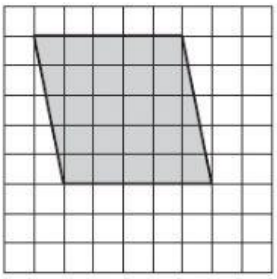

square units

4.



square units

5.

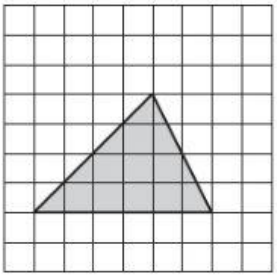

square units

6.

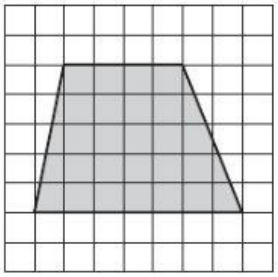

square units

LIVEWORKSHEETS