Збир на аглите во триаголник

Пресметај го непознатиот агол во секој од триаголниците:

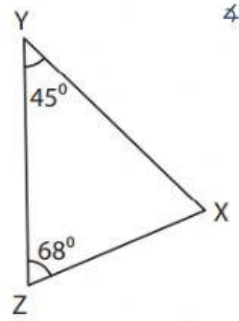

$\measuredangle X + 68° + 45° = 180°$

$\measuredangle X + 113° = 180°$

$\measuredangle X = 180° - 113°$

$\measuredangle X = 67°$

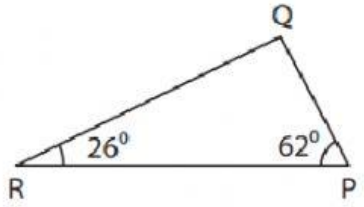

∠Q = _____

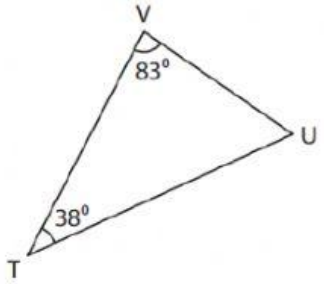

∠U = _____

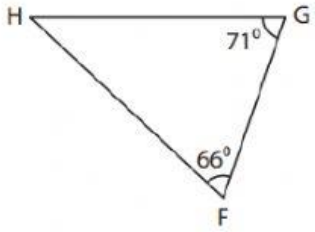

∠H = _____

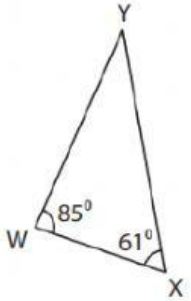

∠Y = _____

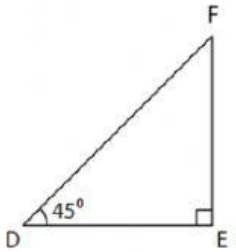

∠F = _____

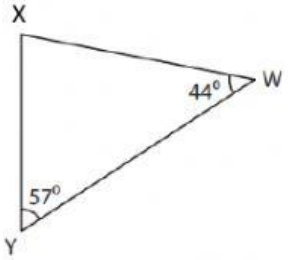

∠X = _____

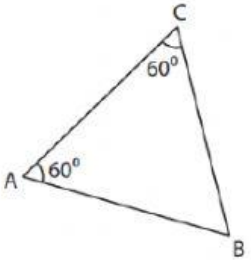

∠B = _____

LIVEWORKSHEETS