Friday 23rd April, 2021
Term 3
Weekly Test 1- Mathematics

1. Write the word name for **16**. _____

2. Select all the sets with **sixteen** objects.

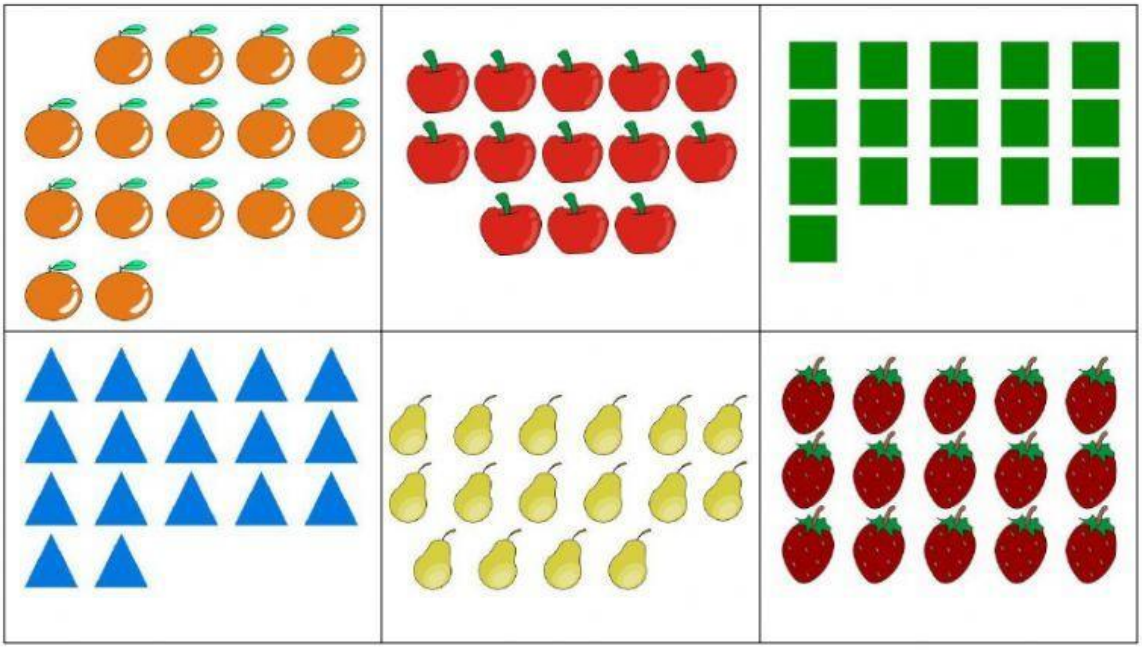

3. Fill in the missing facts.

_____-10=6

16-8=_____

4+_____=16

13+_____=16

16 is _____more than 14.

16 is _____ more than 15.

LIVEWORKSHEETS

4. Solve the following word problems.

Write your number sentence for <u>all</u> word problems.

1. Jermiyah loves animals. She has **5** turtles, **4** parrots and **7** dogs. How many animals she has **in all**?

_____

2. Rashad has **11** apples. Zachariah has **5** bananas.

a. How many fruits they have **altogether**?

_____

b. How many more fruits does Rashad have than Zachariah?

_____

Rashad has _____ more fruits than Zachariah.

5. Number the pictures **(1,2,3,4)** from the **<u>lightest</u>** to the **<u>heaviest</u>**.

LIVEWORKSHEETS

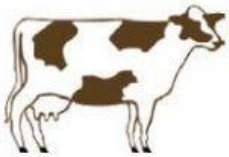

6. Look at the following scales and fill in the blanks with "**heavier**", "**lighter**" or "**same as**".

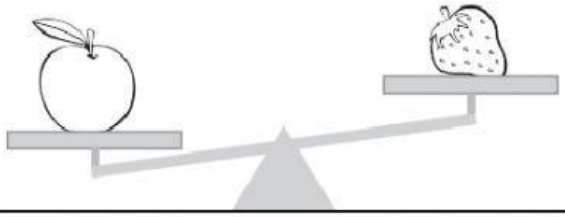

The apple weighs _____ than the strawberry.

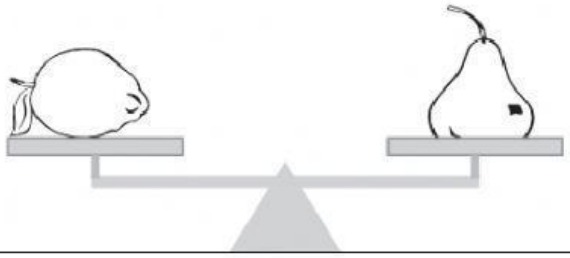

The lemon weighs the_____ the pear.

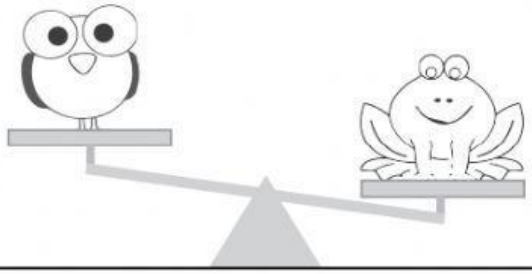

The bird weighs _____ than the frog.

LIVEWORKSHEETS