RAZONES TRIGONOMETRICAS

NOMBRE: _____ Curso: _____

1. Observa las siguientes imágenes y selecciona la razón trigonométrica que corresponde.

Sen | Cos | Tan

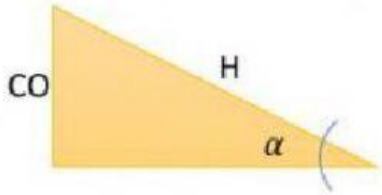

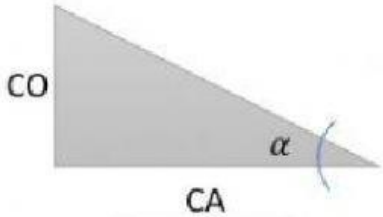

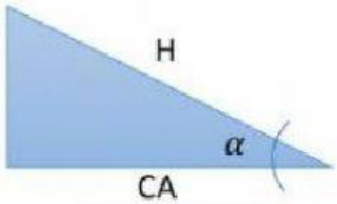

Recuerda: CO=Cateto opuesto CA=Cateto adyacente. H=Hipotenusa

2- Selecciona la función trigonométrica asociada a los datos del triángulo

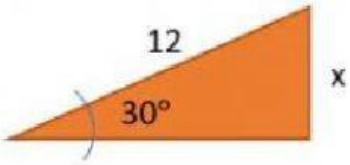

seno
coseno
tangente

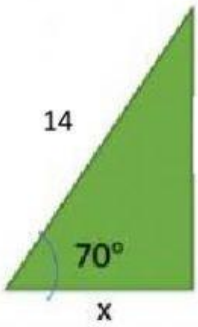

seno
coseno
tangente

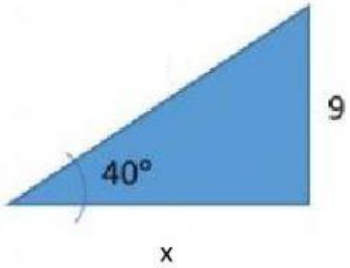

seno
coseno
tangente

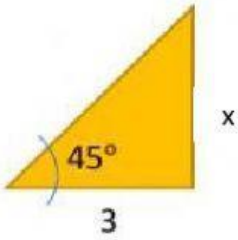

seno
coseno
tangente

LIVEWORKSHEETS