Multiples of 9

9 x 1 = ___

9 x 2 = ___

9 x 3 = ___

9 x 4 = ___



9 x 5 = ___



9 x 6 = ___

LIVEWORKSHEETS

Multiples of 9 (continuation)



9 x 7 = ___



9 x 8 = ___



9 x 9 = ___

LIVEWORKSHEETS

Multiples of 9 (continuation)



9 x 10 = ___

LIVEWORKSHEETS

What are the multiples of 9?
Complete the list.

9	18	___	___	45	54
	___	72	___	___	

LIVEWORKSHEETS