INSTITUTO HEBREO
DR. CHAIM WEIZMANN
בית הספר העברי
Maths Department

Numbers to 20

Name:

A. Complete the chart with the missing numbers.

1				5
	7		9	
11			14	
16		18		

LIVEWORKSHEETS

B. Write the number **before** and **after**.

Before		After	Before		After
	18			7	

8 17 19 6

C. Count the objects and write the number in the box.

Example

2

LIVEWORKSHEETS



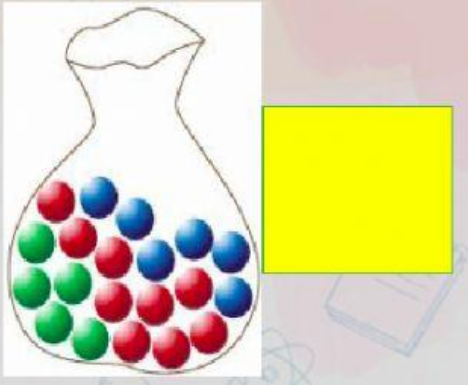

D. Compare which is **smaller, greater** or **equal.**

Example

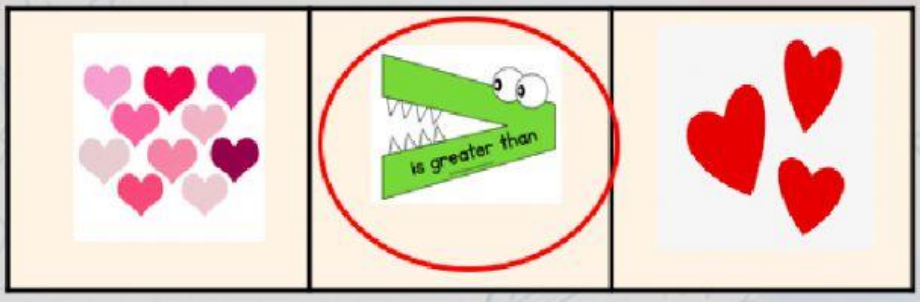

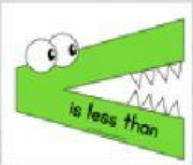

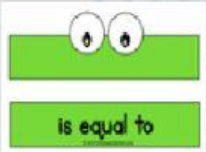

LIVEWORKSHEETS

A.

B.

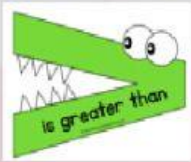

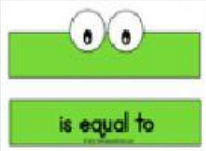

C.

17		17

D.

11		19

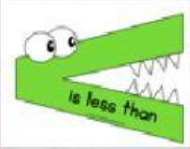



LIVEWORKSHEETS