ST JOHN'S AMERICAN SCHOOL

PRESCHOOL, ELEMENTARY & JUNIOR HIGH SCHOOL

Matemáticas I
Segundo Periodo

Actividad 2.9.- Perímetros y áreas.

Instrucciones: Relaciona cada figura con su correspondiente área.

		Área
Triángulo	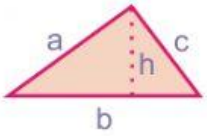	$A = \frac{D * d}{2}$
Paralelogramo	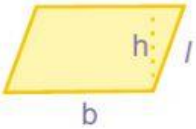	$A = \frac{P * a}{2}$
Rectángulo	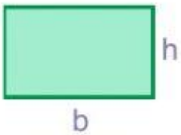	$A = \pi * r^2$
Cuadrado		$A = \frac{(B + b)}{2} * h$
Rombo	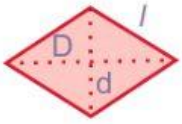	$A = l^2$
Trapecio	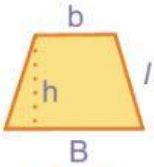	$A = b * h$
Círculo		$A = b * h$
Polígono		$A = \frac{b * h}{2}$

Ed. Dr. Rojas Román Fernando de Jesús

LIVEWORKSHEETS