LES MULTIPLICACIONS

Relaciona cada rectangle o quadrat amb el número total de quadradets i escriu la multiplicació que representa el rectangle.



12 → __ x __



24 → __ x __

18 → __ x __

24 → __ x __



12 → __ x __



18 → __ x __

LIVEWORKSHEETS