Name: Date:

Class:

MEASURING IN KILOGRAMS

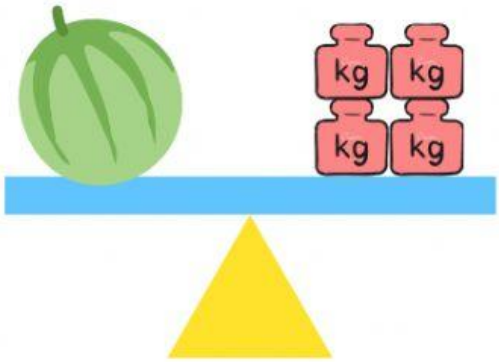

The mass of the melon is ....



The mass of the durian is ....

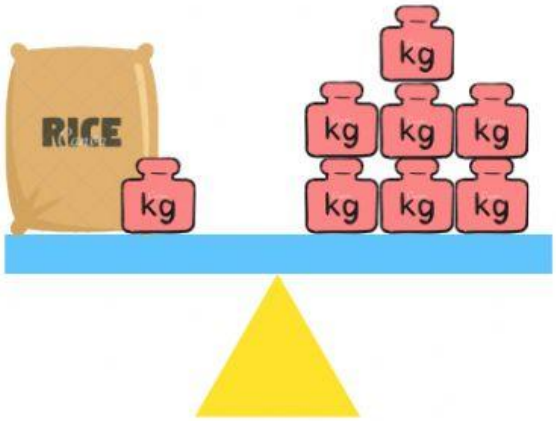

The sack of rice has a mass of ....

LIVEWORKSHEETS

MEASURING IN KILOGRAMS

Complete the sentence by filling the blanks. Choose the option of words bellow.

MORE THAN | LESS THAN | AS HEAVY AS

THE SUGAR IS ..... 1 KG

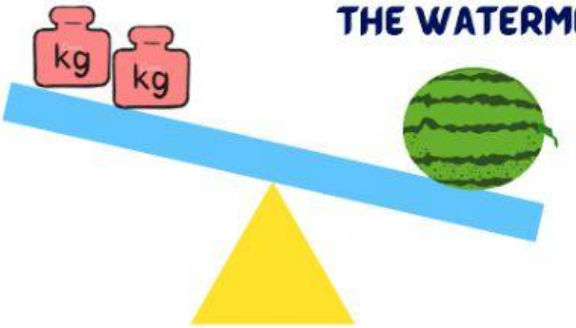

THE WATERMELON IS ..... 2 KG

Read the scales and make the sentence.

A



B



- The mass of the sack of potatoes is..... kg
-

LIVEWORKSHEETS