Revisão Geometria

Áreas de Figuras Planas - Arraste e solte as fórmulas correspondentes

Área do Quadrado

Área do Retângulo

Área do Paralelogramo

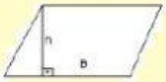

Área do Losango

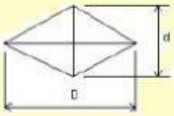

Área do Trapézio

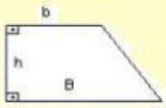

Área do Círculo



Área do Pentágono regular

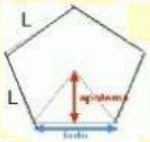

Área de um polígono regular

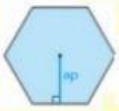

P - perímetro do polígono
ap – apótema.

Triângulos Quaisquer

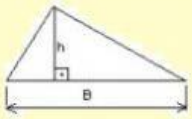

Triângulo Retângulo

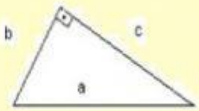

Fórmula de Heron

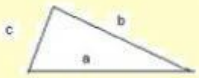

Triângulo Equiláter

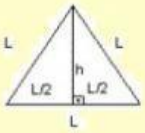

Área do Hexágono regular

Área Setor Circular

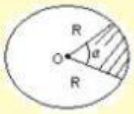

Área Segmento Circular

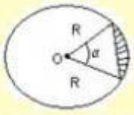

$A_T = b \cdot c / 2$

Área = $\pi \cdot R^2$

Área = $\frac{n \cdot (L \cdot ap)}{2}$

Área = Área SC - Área triângulo

Área = $\frac{\alpha \cdot \pi \cdot R^2}{360°}$

$A_T = \sqrt{p(p-a)(p-b)(p-c)}$

Área = $\frac{\ell^2 \cdot \sqrt{3}}{4}$

Área = $6 \cdot \frac{\ell^2 \cdot \sqrt{3}}{4}$

Área = $\frac{D \cdot d}{2}$

Área = $\frac{(B + b) \cdot h}{2}$

ÁREa = $\frac{B \cdot h}{2}$

Área = b. h
paralelogramo

Área = b. h

Área = $\frac{P \cdot \text{apótema}}{2}$

Área = L^2

LIVEWORKSHEETS