Problem Solving with Money

5 AED



10 AED

20 AED

16 AED

12 AED

7 AED

10 AED

9 AED



15 AED

12 AED



8 AED

12 AED

25 AED

LIVEWORKSHEETS

Problem Solving with Money

Solve the money problems below. Show your working out.

1. Salem bought bread and milk. How much money did he spend?

2. Sara bought chicken and orange juice. How much did she spend?

3. Nawaf bought apples and bananas. How much did he spend?

4. Mahir bought 3 cupkakes. How much did he spend?

5. Reem bought orange juice, bread and apples. How much did she spend?

LIVEWORKSHEETS

LIVEWORKSHEETS