Escola Estadual "Barão de Macaúbas"

"Instruir para viver

1. **Complete** a sequência dos números até 200.

1		3		5		7		9	
	12		14		16		18		20
21		23		25		27		29	
	32		34		36		38		40
41		43		45		47		49	
	52		54		56		58		60
61		63		65		67		69	
	72		74		76		78		80
81		83		85		87		89	
	92		94		96		98		100
101		103		105		107		109	
	112		114		116		118		120
121		123		125		127		129	
	132		134		136		138		140
141		143		145		147		149	
	152		154		156		158		160
161		163		165		167		169	
	172		174		176		178		180
181		183		185		187		189	
	192		194		196		198		200

2. **Descubra** a sequência e **complete**.

100 – 105 – ☐ – ☐ – 120 – ☐ – 130 – ☐ - ☐ – 145 – 150

☐ – 160 – ☐ – ☐ – ☐ - ☐ – ☐ – ☐ – ☐ - 200

LIVEWORKSHEETS

3. **Complete** quadro posicional e depois **escreva** o número por extenso, de acordo com o material dourado, como no modelo.

a)

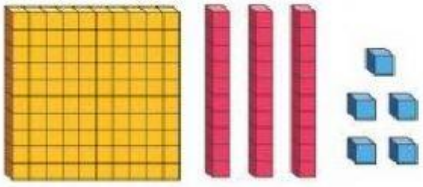

Centenas	Dezenas	Unidades
2	3	5

Duzentos e trinta e cinco

b)

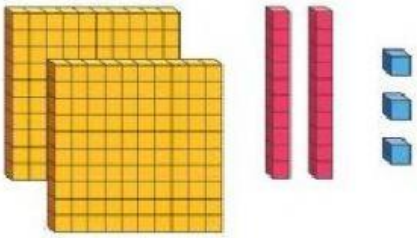

Centenas	Dezenas	Unidades

c)

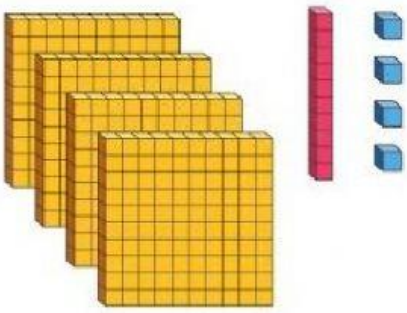

Centenas	Dezenas	Unidades

3. **Escreva** o valor de algarismo

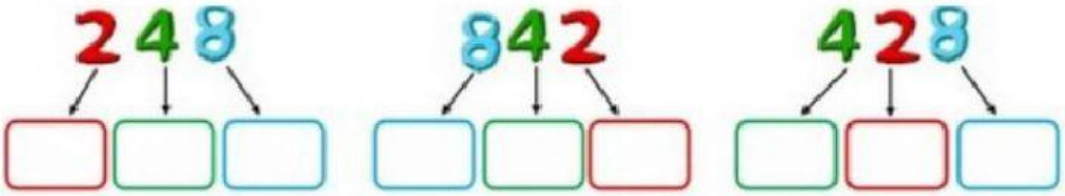

LIVEWORKSHEETS