Math Final Exam
First Term
Transition _____

Name: _____ **Date:** _____

1. Solve the addition word problem, write the answer.



5 horses **and**  **3 more horses** **_____horses**



3 dogs **and** **2 more dogs** **_____dogs**

2. solve the additions. Choose the correct option.

4 dogs and **4** more dogs.	**4** bees and **5** more bees.
4 + 4= _____	4 + 5= _____
(8) (1) (6)	(10) (6) (9)

LIVEWORKSHEETS

3. Match the number sentence that show the same addition in a different order

8 + 4 = 12 •	**10 + 8 = 18** •	**6 + 7 = 13** •
• **8 + 1 0 = 18**	• **7 + 6 = 13**	• **4 + 8 = 12**

4. Solve the subtractions. Now, match and subtract to compare. Write the answer.

There are 8 cats. 6 are white, the rest are black. How many cats are black?
Write the answer



8 – 6 = _____

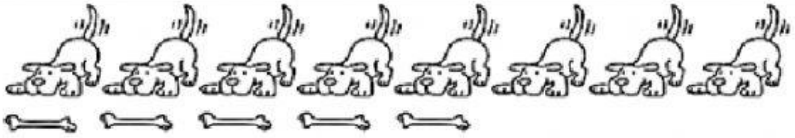

8 – 5 = ____ ____ more

5. Match the model to the number sentence.

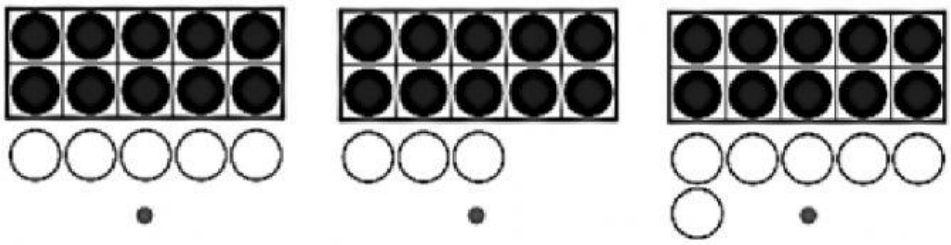

• • •

10 + 3 = 13 10 + 5 = 15 10 + 6 = 16

LIVEWORKSHEETS