Volume of Cubes and Cuboids

Diagram	Volume - ANSWERS
1. 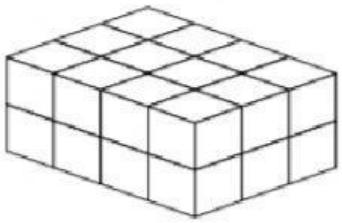	Volume = _____cm^3
2. 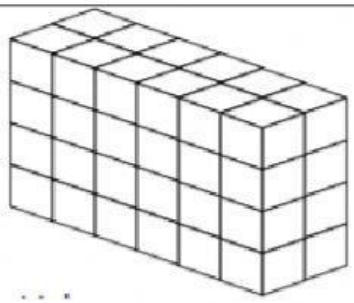	Volume = _____ cm^3
3. 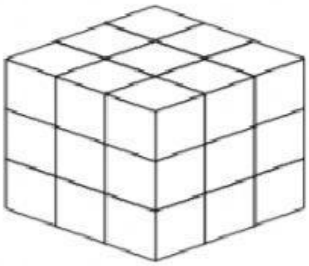	Volume = _____ cm^3
4. 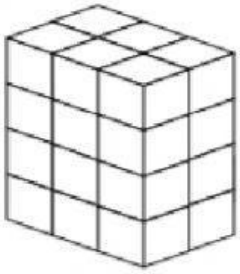	Volume = _____ cm^3

LIVEWORKSHEETS

5. 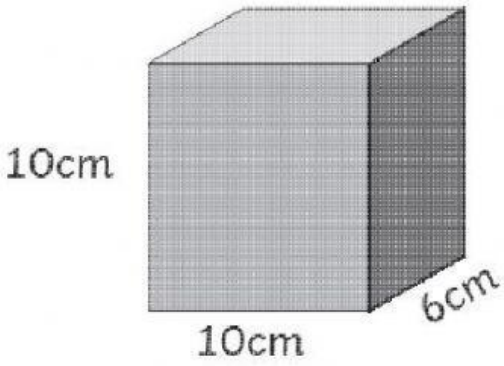	Volume = _____ cm^3
6. 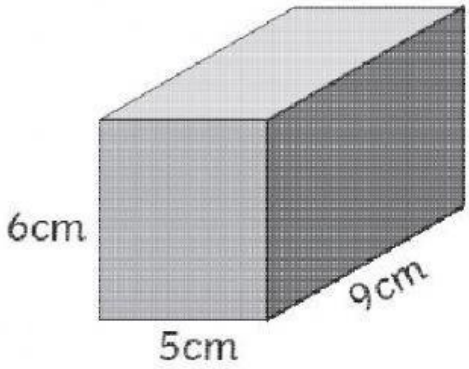	Volume = _____ cm^3
7. 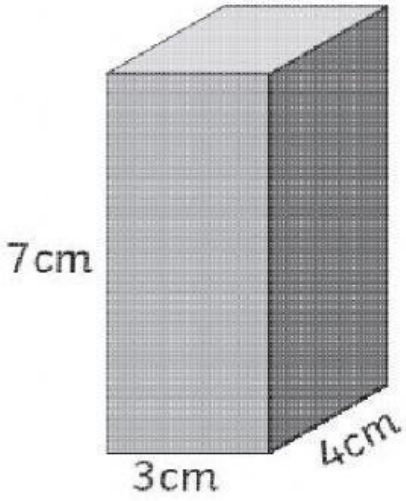	Volume = _____ cm^3

LIVEWORKSHEETS

8. 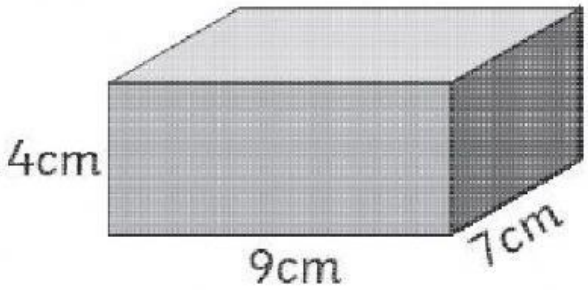	Volume = _____ cm^3

Challenge Send your answer to me on teams chat

Draw 3 different cuboids with a volume of $24cm^3$, writing the dimensions. Your drawings don't need to be to scale.

LIVEWORKSHEETS