Función módulo

1) Completar las siguientes tablas de valores para cada función dada

a) $f(x) = |x-3| + 1$

x	- 2		0	1	
y		5			1

b) $f(x) = |x+3| - 1$

x	- 4			1	
y		2	- 1		0

c) $f(x) = -2.|x-1|$

x	0		- 3	
y		- 4		0

d) $f(x) = -2|x| - 1$

x	0	- 3		2
y			- 3	

e) $f(x) = 4 - |x|$

x	- 1			0
y		- 2	0	

LIVEWORKSHEETS

f) $f(x) = -2 - |x|$

x		1		0
y	- 4		- 6	

2) Indicá a qué función del ejercicio anterior corresponde cada gráfico.

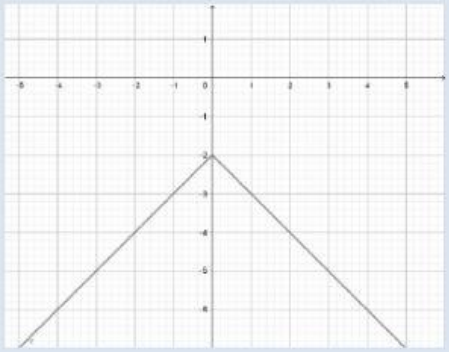

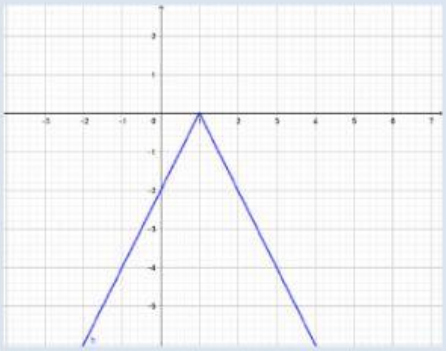

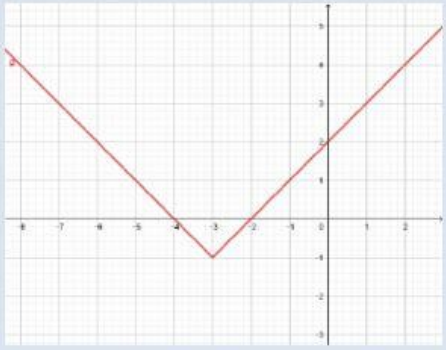

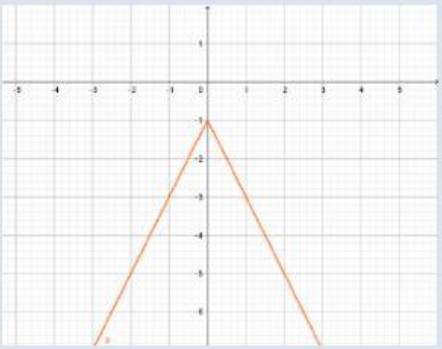

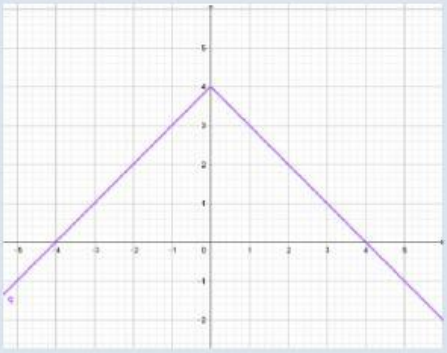

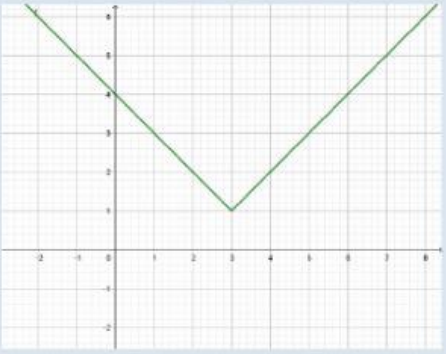

LIVEWORKSHEETS