Let's Learn!

Division without Remainder and Regrouping

1 Mr Ahmad packed 63 tennis balls equally into 3 baskets.
How many tennis balls were there in each basket?

63 ÷ 3 = ?



First, divide the **tens** by 3.
6 tens ÷ 3 = 2 tens in each group

```
   2
3)6 3
  6
```



Then, divide the **ones** by 3.
3 ones ÷ 3 = 1 one in each group

```
   2 1
3)6 3
  6
    3
    3
    0
```

So, 63 ÷ 3 = 21.

There were 21 tennis balls in each basket.

LIVEWORKSHEETS

2 Divide **44** by 2.

44 ÷ 2 = ?



First, divide the **tens** by ☐

4 tens ÷ 2 = ☐ tens in each group

☐
2) 4 4
☐



Then, divide the **ones** by 2.

4 ones ÷ 2 = ☐ ones in each group

2☐
2) 4 4
4
☐
☐
☐

So, 44 ÷ 2 = ☐.

LIVEWORKSHEETS