NAMA : .....

KELAS : .....

NO. ABSEN : .....

LEMBAR KERJA SISWA (LKS) MATEMATIKA
BANGUN RUANG

Jawablah pertanyaan-pertanyaan berikut dengan benar!

1. Mainan rubik mengambil bentuk bangun ruang...
   a. Balok
   b. Kubus
   c. Prisma
   d. Tabung

2. Di bawah ini adalah bangun ruang...

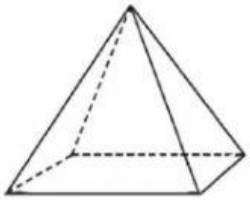

   a. Limas segitiga
   b. Limas segiempat
   c. Prisma segitiga
   d. Prisma segiempat

3. Di bawah ini adalah gambar jaring-jaring bangun ruang...

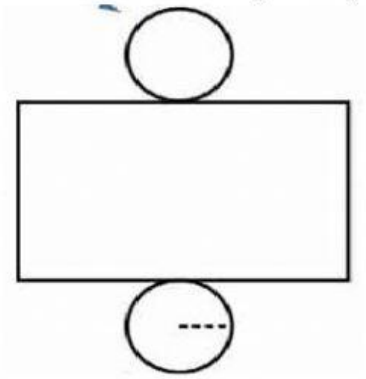

   a. Tabung
   b. Kerucut
   c. Limas
   d. Prisma

LIVEWORKSHEETS

4. Tariklah garis ke jawaban yang benar!

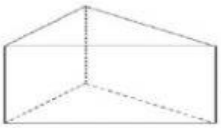

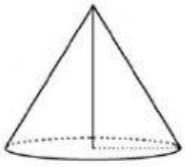

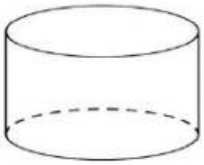

Kerucut
Tabung
Prisma Segitiga

5. Tariklah rumus yang sesuai dengan gambar!

Bangun Ruang	**Rumus Volume**
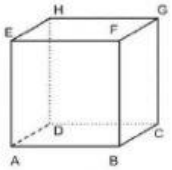	
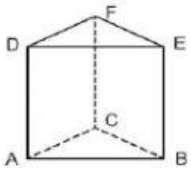	
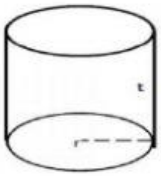	
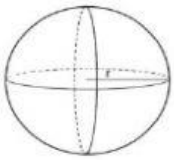	

$V = \pi \times r^{2 \times} t$
$V = s \times s \times s$
V = Luas alas x tinggi
$V = 4/3 \times \pi \times r^3$

LIVEWORKSHEETS