ΟΝΟΜΑ: _____

ΜΕΤΡΗΣΗ ΜΑΖΑΣ

ΗΜΕΡΟΜΗΝΙΑ: _____

- Επίλεξε τις εικόνες που σου φαίνονται σωστές:

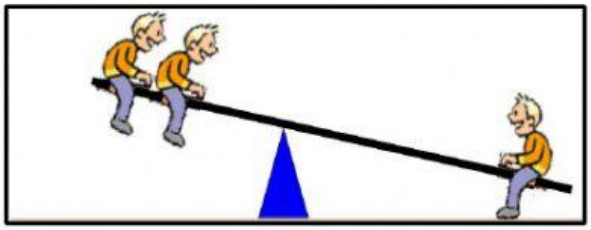

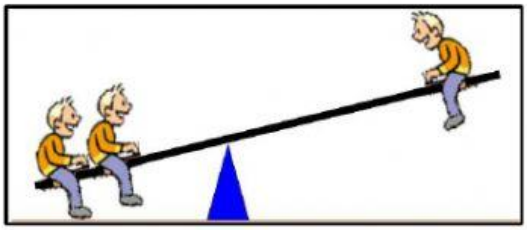

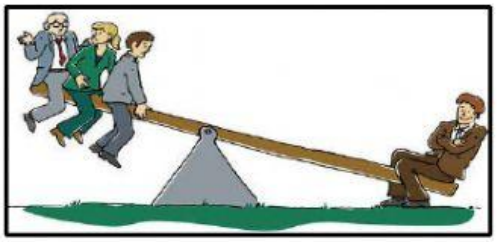





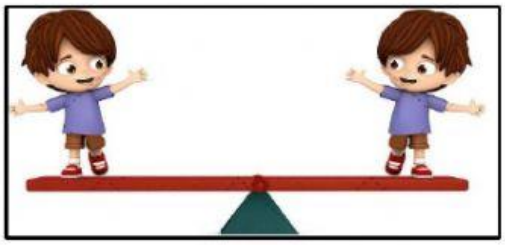





❖ Τι από τα παρακάτω συμβαίνει όταν κάνουμε τραμπάλα; Σημείωσε **Σ** για σωστό και **Λ** για λάθος:

- Ο πιο βαρύς σηκώνει τον πιο ελαφρύ..... Σ Λ
- Ο πιο ελαφρύς σηκώνει τον πιο βαρύ..... Σ Λ
- Το βάρος δεν παίζει ρόλο, πάντα ισορροπούμε.....Σ Λ
- Αν έχουμε ίδιο βάρος ισορροπούμε.....Σ Λ

LIVEWORKSHEETS

- Βάλε φρούτα στη άδεια μεριά της ζυγαριάς έτσι ώστε να ισορροπεί:





LIVEWORKSHEETS





- Παρατήρησε το βάρος του κάθε φρούτου και συμπλήρωσε τις ζυγαριές έτσι ώστε να ισορροπούν:

= 4 κιλά

= 1 κιλό

= μισό κιλό



LIVEWORKSHEETS







LIVEWORKSHEETS