ورقة عمل (العناصر والمركبات)

اختاري أي من المواد التالية عنصر وأي منها مركب :-

-1

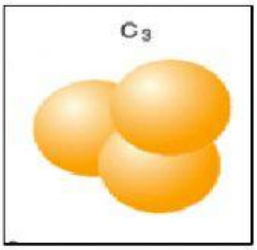

عنصر

مركب

-2

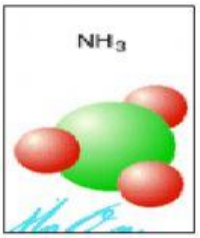

عنصر

مركب

-3

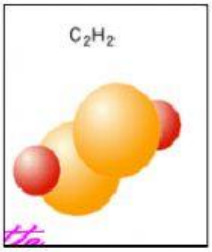

عنصر

مركب

-4

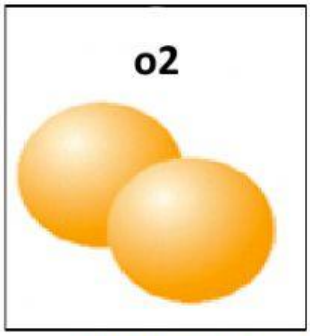

عنصر

مركب

LIVEWORKSHEETS