COUNT THE OBJECTS

Count each group. Write the number in the empty box.

Name: _____ **Date:** _____

Count the apples



Answer

Count the stars



Answer

Count the balloons



Answer

Count the apples



Answer

LIVEWORKSHEETS

DRAG AND DROP

Drag the missing number card into each empty space.

A. 1 | 2 | | 4 | 5

B. 6 | | 8 | 9 | 10

C. 11 | 12 | 13 | | 15

D. 16 | | 18 | 19 | 20

NUMBER CARDS

3 | 7 | 14 | 17

LIVEWORKSHEETS

MIX AND MATCH

Match each number sentence to its answer by drawing a line.

3 + 4	●	●	7
9 – 5	●	●	8
6 + 2	●	●	10
10 – 3	●	●	4
5 + 5	●	●	8
12 – 4	●	●	7

LIVEWORKSHEETS

TRUE OR FALSE?

Read each number sentence. Choose TRUE or FALSE.

2 + 6 = 9	
9 – 4 = 5	
3 + 5 = 8	
10 – 2 = 7	
7 + 2 = 9	
12 – 5 = 6	
4 + 4 = 8	
11 – 3 = 8	

LIVEWORKSHEETS

CHOOSE THE CORRECT ANSWER

Work out each sum. Select the correct answer.

8 + 4 =

10 | 12 | 14

14 – 6 =

6 | 8 | 9

7 + 5 =

11 | 12 | 13

16 – 9 =

6 | 7 | 8

9 + 3 =

10 | 11 | 12

13 – 5 =

7 | 8 | 9

LIVEWORKSHEETS

APPLE TREE COUNTING

Count the apples on each tree. Drag the correct number to the box.

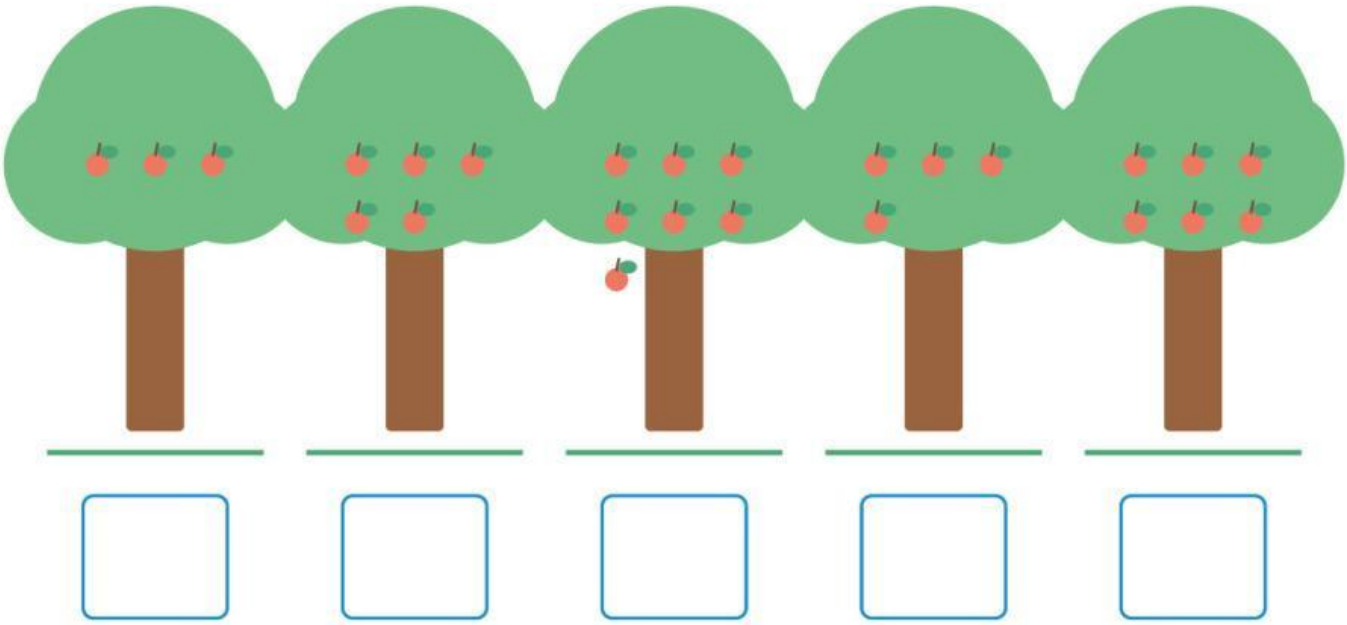

NUMBER CARDS

3	4	5	6	7

LIVEWORKSHEETS

USE THE NUMBER LINE

Use the number line to help you solve each question.

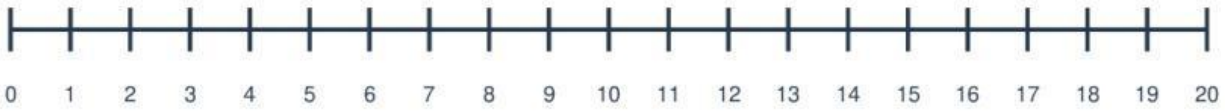

5 + 3 = Start at 5. Move 3 steps forwards.

8 + 4 = Start at 8. Move 4 steps forwards.

12 – 4 = Start at 12. Move 4 steps backwards.

15 – 5 = Start at 15. Move 5 steps backwards.

LIVEWORKSHEETS

FIND THE MISSING NUMBER

Work out the missing number in each number sentence.

5 + ■ = 9	12 – ■ = 7
■ + 4 = 10	15 – 5 = ■
6 + ■ = 13	■ – 3 = 8
9 + 2 = ■	14 – ■ = 6

LIVEWORKSHEETS

SOLVE THE STORY PROBLEMS

Read each story. Work out the answer and fill in the empty box.

QUESTION 1

There are 5 birds in a tree. 3 more birds arrive. How many birds are there now?

Answer



QUESTION 2

Mia has 9 balloons. 4 balloons fly away. How many balloons are left?

Answer



QUESTION 3

There are 6 apples in a basket. Mum adds 2 more. How many apples are there?

Answer



LIVEWORKSHEETS

MATHS CHALLENGE

Answer each question. Check your work when you finish.

1. **Which sign makes this number sentence correct? 7 ■ 2 = 9**

2. **Calculate: 13 – 4 =**

3. **Calculate: 6 + 8 =**

4. **Complete the pattern: 2, 4, 6, ■, 10**

END OF ASSESSMENT

5. **There are 10 oranges. 3 are eaten. How many are left?**

LIVEWORKSHEETS