Las figuras planas.

1. ¿Cómo se llama cada polígono?

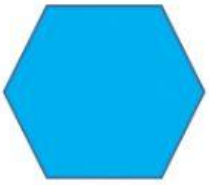

Cuadrilátero Triángulo Pentágono Hexágono Octógono


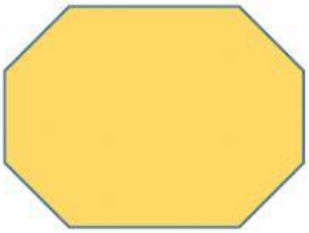

2.Une que cada triángulo según sus lados:



Escaleno Isósceles Equilátero


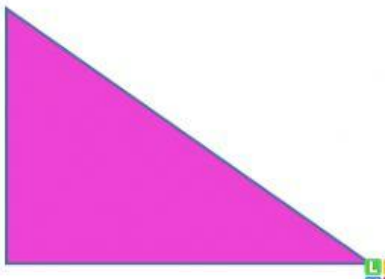

LIVEWORKSHEETS