Ma	Name: _____ gemischte Übungen	Klasse: 2b



Ich bin fit im Rechnen bis 100!

20 + 23 = ____	71 + 12 = ____	11 - 10 = ____
75 - 23 = ____	64 - 31 = ____	54 + 35 = ____
12 + 30 = ____	54 + 24 = ____	75 + 24 = ____
22 - 10 = ____	31 - 21 = ____	50 - 20 = ____

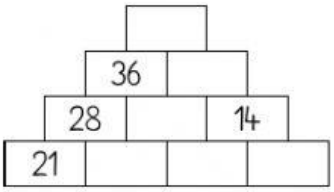

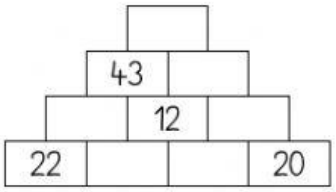

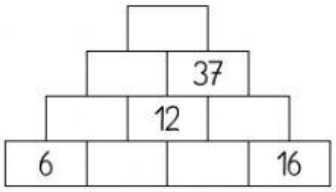

____ - 4 = 29	____ + 8 = 74	____ - 4 = 57	____ - 9 = 63
____ + 4 = 61	____ + 7 = 82	____ + 7 = 51	____ + 4 = 23
____ - 6 = 58	____ - 9 = 2	____ + 3 = 81	____ - 6 = 47

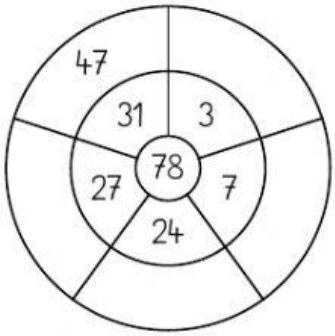

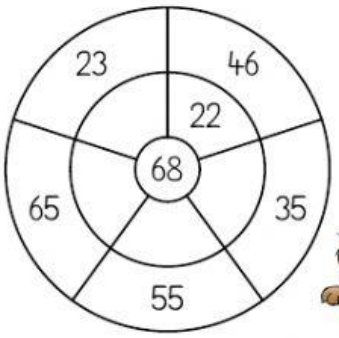

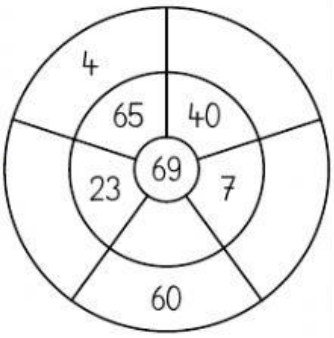

55 - ____ = 7	72 - ____ = 49	56 + ____ = 91	13 + ____ = 31
13 + ____ = 52	57 + ____ = 76	68 - ____ = 29	44 + ____ = 71
55 + ____ = 93	68 - ____ = 9	47 - ____ = 29	83 - ____ = 69

Am Kirschbaum hängen 23 Kirschen. 8 Kirschen fressen die Stare, 3 Kirschen fressen die Rotkehlchen.

Frage: Wie viele Kirschen sind noch übrig?

A:

LIVEWORKSHEETS