MATES TEMA 11: UNITATS DE SUPERFÍCIE

1. Compta i escriu quina és l'àrea de cada figura:



___ y ___

Àrea = ___

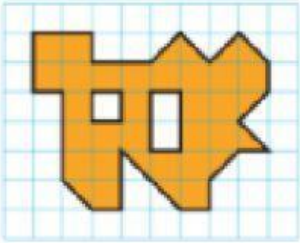

___ y ___

Àrea = ___

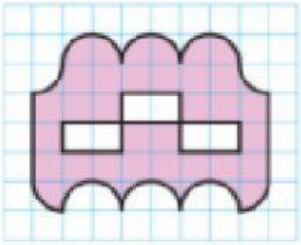

Àrea = ___

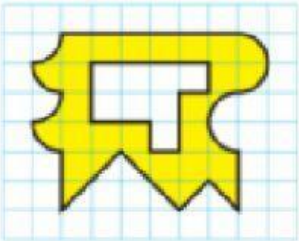

Àrea = ___

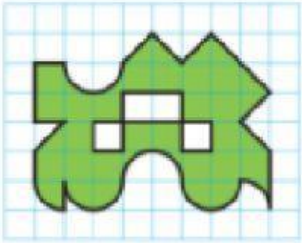

Àrea = ___

2. Observa i escriu l'àrea de cada figura:

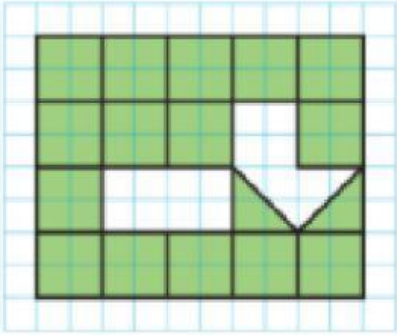

Àrea = ___ = ___

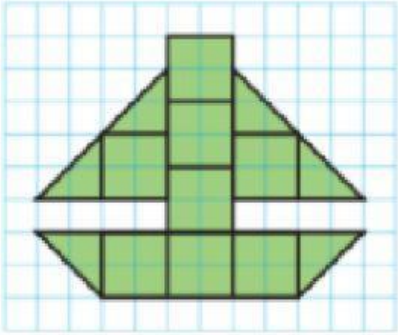

1 = 4

Àrea = ___ = ___

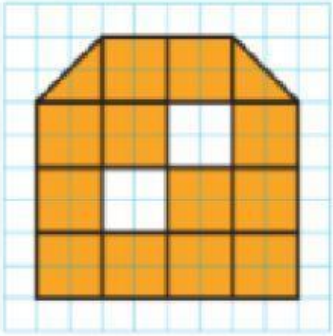

Àrea = ___ = ___ = ___

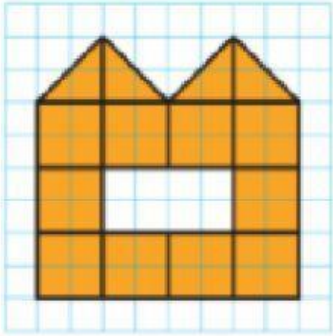

1 = 4

1 = 4

Àrea = ___ = ___ = ___

LIVEWORKSHEETS