1. Labelkan bahagian-bahagian bulatan berpusat O pada rajah di bawah.

1.

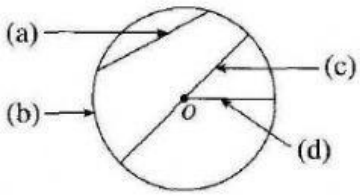

(a) .....

(b) .....

(c) .....

(d) .....

2.

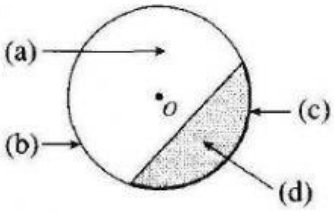

(a) .....

(b) .....

(c) .....

(d) .....

3.

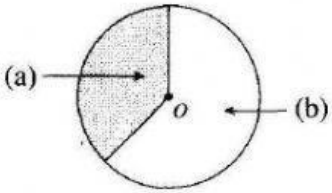

(a) .....

(b) .....

4.

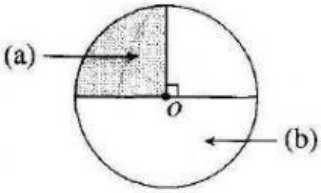

(a) .....

(b) .....

Diameter
Jejari
Lengkok major
Lengkok minor
Lilitan
Perentas
Sektor major
Sektor minor
Semibulatan
Sukuan bulatan
Tembereng major
Tembereng minor

2. Berdasarkan bulatan di bawah, namakan bahagian bulatan yang berikut.

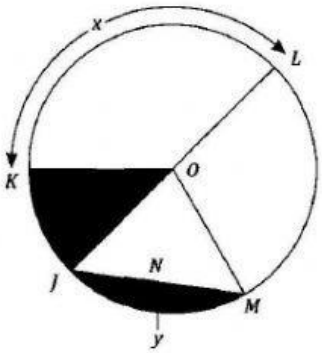

(a) *JOL*	
(b) *OL*	
(c) *JNM*	
(d) *OJK*	
(e) *x*	
(f) *y*	
(g) *JKLMJ*	

LIVEWORKSHEETS
LIVEWORKSHEETS