Math Fractions

Circle the fraction that represents the shaded part of the whole:



$\frac{1}{2}$ $\frac{3}{4}$ $\frac{1}{4}$ $\frac{2}{6}$



$\frac{2}{4}$ $\frac{7}{8}$ $\frac{3}{8}$ $\frac{1}{8}$

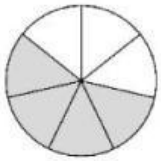

$\frac{4}{7}$ $\frac{2}{3}$ $\frac{4}{8}$ $\frac{3}{7}$



$\frac{5}{5}$ $\frac{4}{6}$ $\frac{1}{5}$ $\frac{4}{5}$

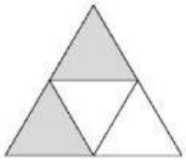

$\frac{3}{4}$ $\frac{2}{2}$ $\frac{1}{2}$ $\frac{1}{4}$

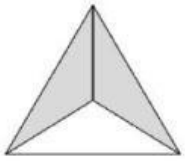

$\frac{2}{3}$ $\frac{1}{3}$ $\frac{3}{3}$ $\frac{3}{2}$

LIVEWORKSHEETS