## Selecciona la fracción correcta

| | | |
|---|---|---|
| $\frac{2}{10}$ | $\frac{5}{9}$ | $\frac{7}{10}$ |

| | | |
|---|---|---|
| $\frac{4}{6}$ | $\frac{1}{5}$ | $\frac{3}{6}$ |

| | | |
|---|---|---|
| $\frac{2}{10}$ | $\frac{5}{9}$ | $\frac{9}{10}$ |

| | | |
|---|---|---|
| $\frac{2}{6}$ | $\frac{1}{5}$ | $\frac{3}{6}$ |



| | | |
|---|---|---|
| $\frac{3}{6}$ | $\frac{2}{4}$ | $\frac{3}{5}$ |

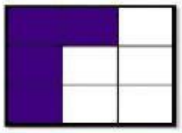

| | | |
|---|---|---|
| $\frac{4}{8}$ | $\frac{4}{9}$ | $\frac{5}{9}$ |



| | | |
|---|---|---|
| $\frac{3}{6}$ | $\frac{2}{4}$ | $\frac{4}{5}$ |

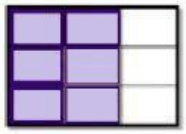

| | | |
|---|---|---|
| $\frac{4}{8}$ | $\frac{4}{9}$ | $\frac{6}{9}$ |

## Observa y elige el inciso correcto



a) Dos medios
b) Un medio
c) Una mitad

a) Tres tercios
b) Dos tercios
c) Un tercio



a) Nueve décimos
b) Nueve octavos
c) Nueve novenos

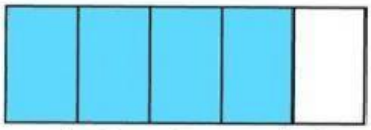

a) Cuatro quintos
b) Un cuarto
c) Cuatro cinco



a) Tres tercios
b) Tres sextos
c) Tres tres

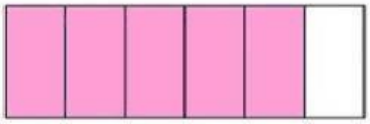

a) Cinco y uno
b) Un quinto
c) Cinco sextos

## Relaciona cada fracción con su forma de leerla

$\frac{2}{3}$

$\frac{1}{2}$

$\frac{3}{4}$

TRES CUARTOS

DOS TERCIOS

UN MEDIO

SEIS DÉCIMOS

CUATRO QUINTOS

SIETE NOVENOS

$\frac{4}{5}$

$\frac{7}{9}$

$\frac{6}{10}$

LIVEWORKSHEETS