Họ tên:

PHIẾU HỌC TẬP

Ôn tập phép cộng trong phạm vi 10

Bài tập 1: Kéo thả số vào ô tương ứng số lượng sự vật

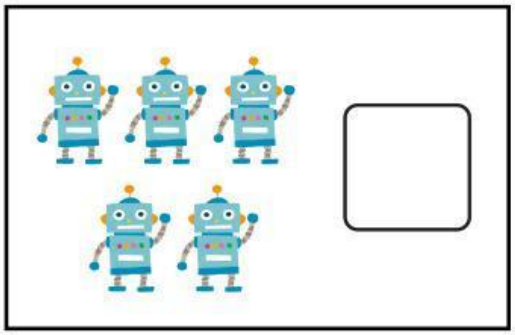

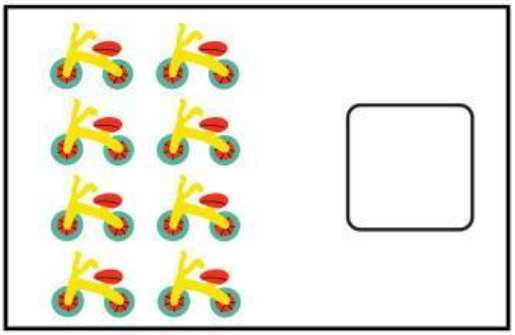

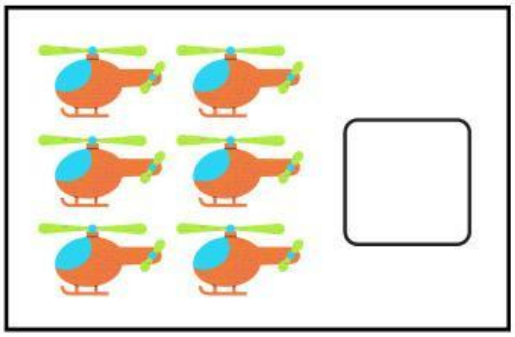





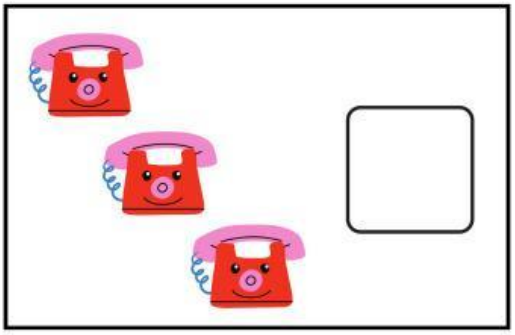

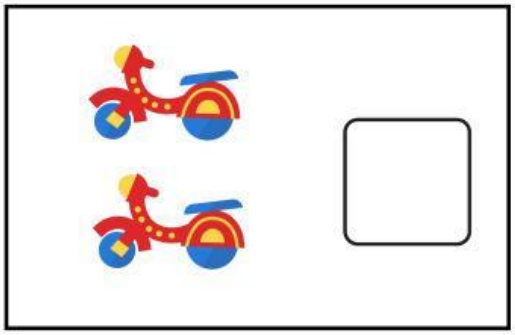

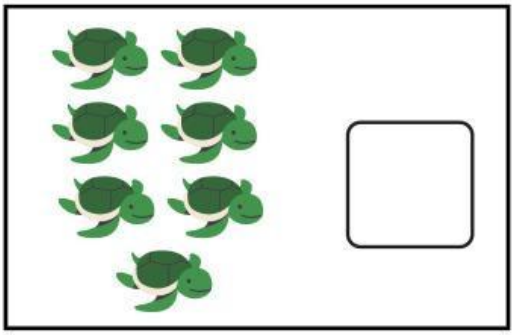

5

2

6

8

3

9

4

7

LIVEWORKSHEETS

Bài tập 2: Điền đáp án vào ô trống

+ 3 =

+ 2 =


+ 4 =

+ 1 =

+ 5 =

+ 6 =

Bài tập 3: Nối hình ảnh với phép tính tương ứng





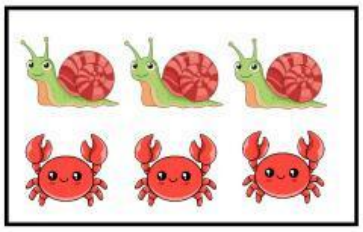

4 + 4

3 + 3

4 + 3

1 + 3

2 + 3

5 + 5







LIVEWORKSHEETS