Butterfly Garden Subtraction

Use the pictures to help subtract.

9 - 5 = ____



10 - 4 = ____

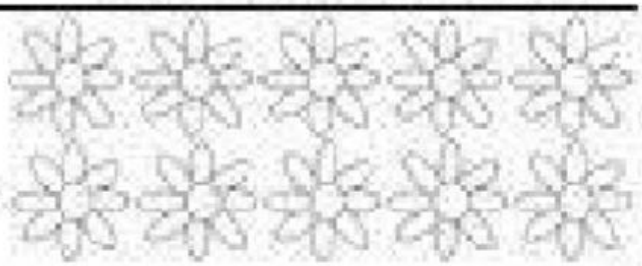

8 - 2 = ____



8 - 4 = ____



10 - 5 = ____



9 - 8 = ____

LIVEWORKSHEETS