OSSERVA L'IMMAGINE E COMPLETA LA TABELLA: QUANTI GRUPPI? (DECINE) QUANTI OGGETTI DA SOLI? (UNITÀ)



DECINE	UNITÀ



DECINE	UNITÀ

DECINE	UNITÀ

DECINE	UNITÀ

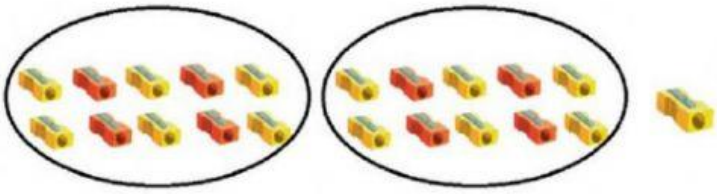

DECINE	UNITÀ

DECINE	UNITÀ

DECINE	UNITÀ

LIVEWORKSHEETS