Họ và tên: _____ Ngày: _____

1. Điền số còn thiếu

2. Khoanh tròn đám mây mang số bé nhất

3. Tick vào số lớn hơn trong mỗi nhóm

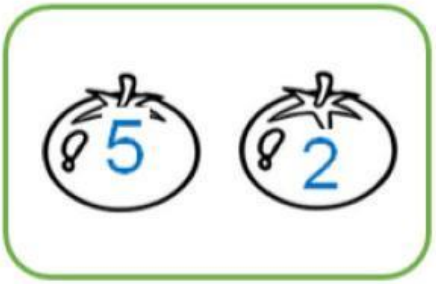

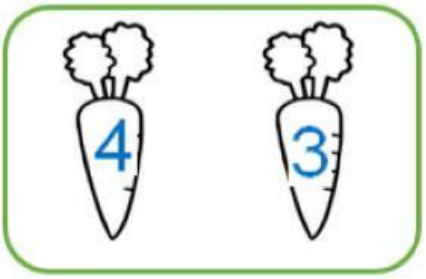





LIVEWORKSHEETS

4. Sắp xếp số theo thứ tự từ bé đến lớn



5 1 4 9 → 1 4 5 9



2 7 1 6 → ☐ ☐ ☐ ☐



8 6 4 7 → ☐ ☐ ☐ ☐



3 9 1 2 → ☐ ☐ ☐ ☐

5. Sắp xếp số theo thứ tự từ lớn đến bé



3 9 1 2 → ☐ ☐ ☐ ☐



4 2 7 3 → ☐ ☐ ☐ ☐



7 5 3 1 → ☐ ☐ ☐ ☐



9 8 5 4 → ☐ ☐ ☐ ☐

LIVEWORKSHEETS