Kinetic or potential energy?

1. Write the type of energy that is being shown

A ball Rolling.  _____	A soda tin not opened. _____	A boy throwing a ball.  _____
A ball before being kicked. _____	A car moving.  _____	Books on the table 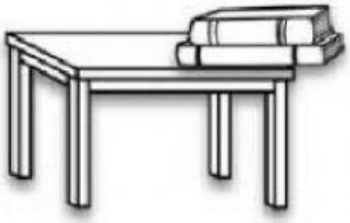 _____

2. What is the potential energy?

3. What is the kinetic energy?

LIVEWORKSHEETS

Determine if the picture is illustrating Kinetic or Potential Energy.

Kinetic

Potential

Kinetic

Potential

Kinetic

Potential

Kinetic

Potential

Coal

Kinetic

Potential

Kinetic

Potential

Kinetic

Potential

Kinetic

Potential

Kinetic

Potential

Kinetic

Potential

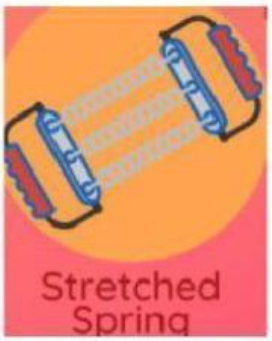

Kinetic

Potential

Kinetic

Potential

Kinetic

Potential

Kinetic

Potential

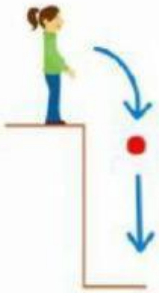

Kinetic

Potential

Kinetic

Potential

LIVEWORKSHEETS

Complete each sentence with the corresponding word.

Potential or Kinetic?

Potential Energy is stored energy and is waiting to work.
Kinetic Energy is energy that is working.

The apple in the table is _____energy.

The apple falling from the table is _____energy.

If the rock falls from the hill, it is _____ energy.

If the rock is still, it is_____ energy.

If the cyclist is still, he has _____energy.

If he is moving, he has _____energy.

If the yoyo is still at the top, it is_____energy.

If the yoyo is moving, it is _____energy.

If the boy throws the ball is _____energy.

The ball on the boy's hand is_____energy.

LIVEWORKSHEETS