LKPD

ILMU PENGETAHUN ALAM

Tema Sistem Pernafasan Manusia



Nama: Kelas:

LIVEWORKSHEETS

MENGENAL
ORGAN PERNAPASAN

Nama: Kelas:

Panduan

Amati gambar organ-organ pernafasan manusia.
Lengkapi nama-nama organ pernapasan di bawah ini!



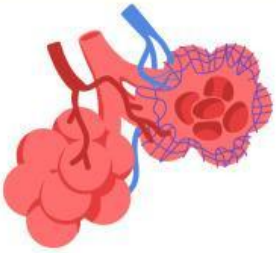

LIVEWORKSHEETS

MENCOCOKAN
ORGAN PERNAPASAN

Nama: Kelas:

Panduan Amati gambar organ-organ pernafasan manusia di sebelah kiri. Hubungkan dengan nama oragan tersebut.

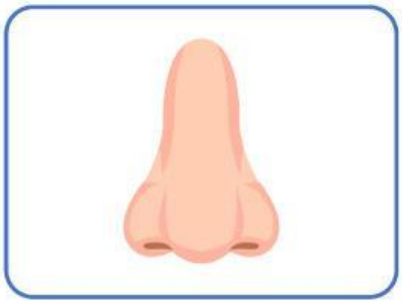

- **Faring**

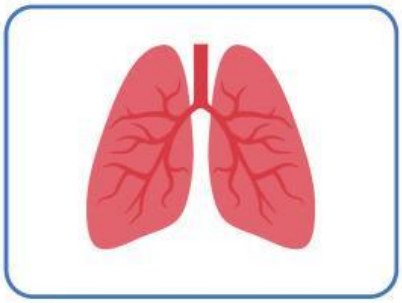

- **Paru-Paru**

- **Hidung**

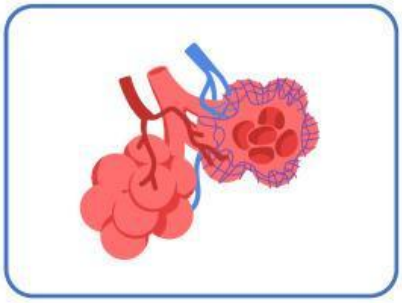

- **Alveolus**

LIVEWORKSHEETS

FUNGSI
ORGAN PERNAPASAN

Nama: Kelas:

Panduan Tuliskan fungsinya organ-organ pernafsan manusia, yang sesuai dengan organ tersebut.

ORGAN	FUNGSI
Hidung	
Faring	
Laring	
Trakea	
Paru-Paru	

LIVEWORKSHEETS